Dividing with a Numberline

Name:

Use the numberline to solve each problem.

1) 6 ÷ 2 =



2) 8 ÷ 4 =

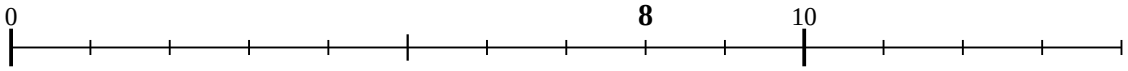

3) 18 ÷ 9 =

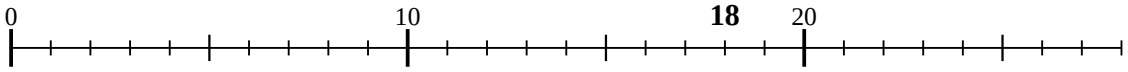

4) 36 ÷ 9 =

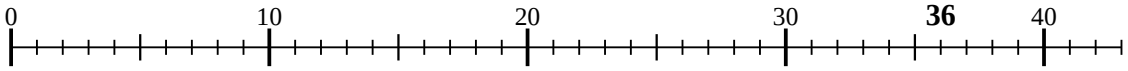

5) 40 ÷ 8 =

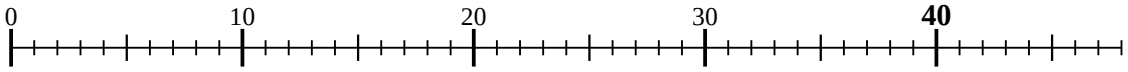

6) 10 ÷ 5 =

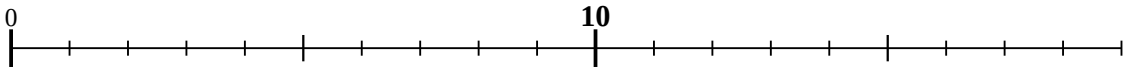

7) 14 ÷ 7 =

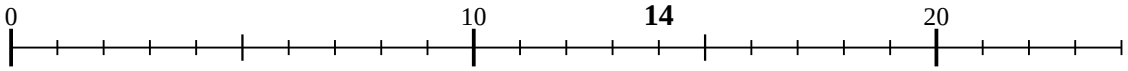

8) 12 ÷ 3 =

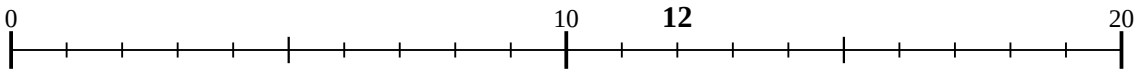

9) 6 ÷ 3 =

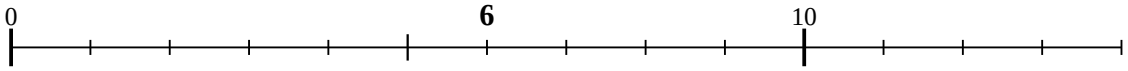

10) 16 ÷ 4 =

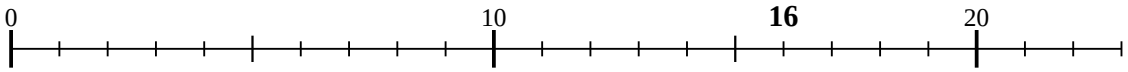

11) 15 ÷ 3 =

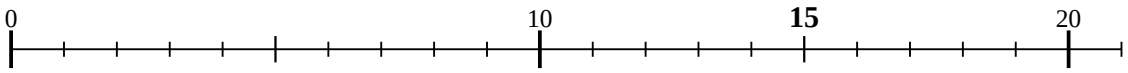

Answers

1. _____
2. _____
3. _____
4. _____
5. _____
6. _____
7. _____
8. _____
9. _____
10. _____
11. _____

1-10	91	82	73	64	55	45	36	27	18	9
11	0									

Dividing with a Numberline

Name: **Answer Key**

Use the numberline to solve each problem.

1) 6 ÷ 2 =

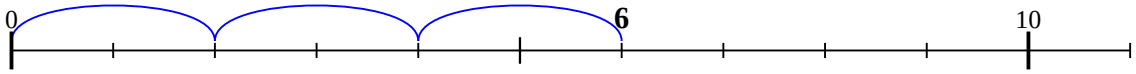

2) 8 ÷ 4 =

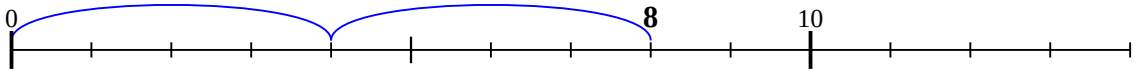

3) 18 ÷ 9 =

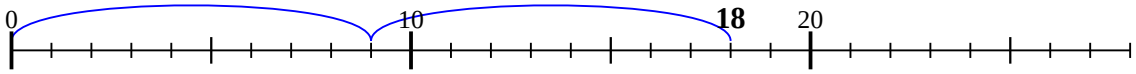

4) 36 ÷ 9 =

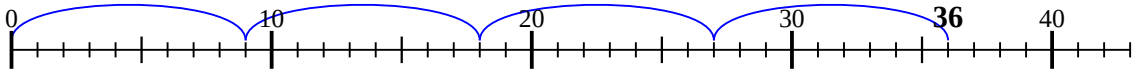

5) 40 ÷ 8 =

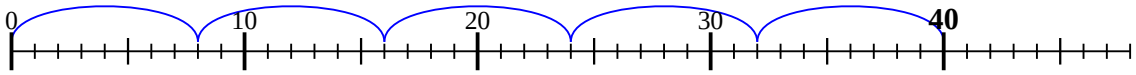

6) 10 ÷ 5 =

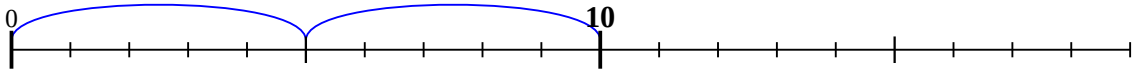

7) 14 ÷ 7 =

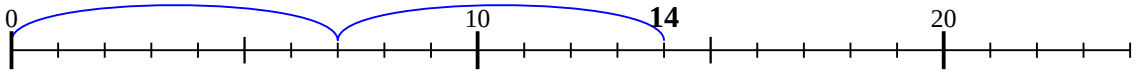

8) 12 ÷ 3 =

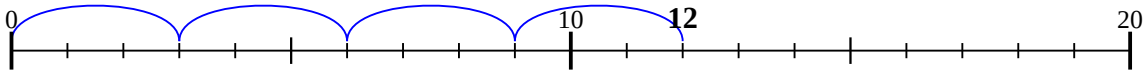

9) 6 ÷ 3 =

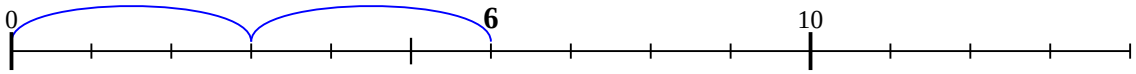

10) 16 ÷ 4 =

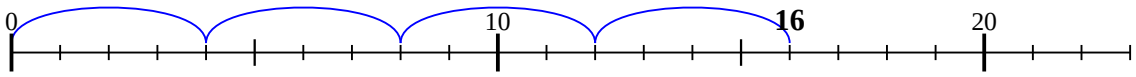

11) 15 ÷ 3 =

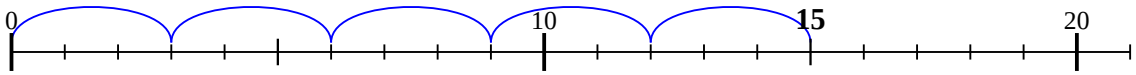

Answers

1. 3
2. 2
3. 2
4. 4
5. 5
6. 2
7. 2
8. 4
9. 2
10. 4
11. 5

1-10	91	82	73	64	55	45	36	27	18	9
11	0									